All rights reserved. No part of this publication may be reproduced, distributed, or transmitted in any form or by any means, electronic, mechanical, photocopying, recording or otherwise, or stored in any retrieval system of any nature without the permission of cracku.in, application for which shall be made to support@cracku.in

Downloaded from cracku.in

# SSC CHSL 30th May 2022 Shift-3

## English Language

1. **Select the option that will improve the underlined part of the given sentence.**
   **The South Indian dish was <u>approved by the guests</u> as it was tasty.**

**A** accepted by the visitors

**B** gratified by the visitors

**C** doomed by the visitors

**D** condemned by the visitors

**Answer:** A

2. **Select the most appropriate option to fill in the blank.**
   **She's been off work with _____ stomach.**

**A** an upset

**B** an overset

**C** an agitated

**D** a perturbed

**Answer:** A

3. **Select the most appropriate option to fill in the blank.**
   **Rohan is _____ self-sufficient man who needs no assistance.**

**A** in

**B** a

**C** the

**D** of

**Answer:** B

4. **Select the INCORRECTLY spelt word.**

**A** Correspondence

**B** Campaign

**C** Experiment

**D** Accommadation

**Answer:** D

SSC CHSL Free Mock Test

5. **Select the most appropriate meaning of the highlighted idiom.**
   **My friend was playing the devil's advocate in the discussion.**

Downloaded from cracku.in

**A** One who is composed at all times

**B** One who argues against something just for the sake of arguing

**C** One who is good at judgement

**D** One who pits the culprit against the lawyer

**Answer:** B

6. **Select the most appropriate ANTONYM of the given word.**
   **Suffice**

**A** Excessed

**B** Immatured

**C** Satirize

**D** Dissatisfy

**Answer:** D

7. **Select the most appropriate synonym of the given word.**
   **Opulence**

**A** View

**B** Sagacity

**C** Recognition

**D** Prosperity

**Answer:** D

SSC CHSL Prevoius Papers (DOWNLOAD PDF)

8. **Select the most appropriate meaning of the given idiom.**
   **Back out**

**A** To stand out

**B** To move backwards

**C** To withdraw from

**D** To pull over

**Answer:** C

9. **The following sentence has been split into four segments. Identify the segment that contains a grammatical error.**
   **Suchitra will have / to wait another month / before she received / any reply to her letter.**

**A** any reply to her letter

**B** to wait another month

**C** Suchitra will have

Downloaded from cracku.in

**D** before she received

**Answer:** D

10. **Select the most appropriate option that can substitute the underlined segment in the given sentence.**
**My mom told me to have cleaning up the kitchen before I go outside.**

**A** to have clean out

**B** to clean up

**C** to clean over

**D** to clean out

**Answer:** B

SSC CGL Previous Papers (DOWNLOAD PDF)

11. **Select the INCORRECTLY spelt word.**

**A** Protocol

**B** Medal

**C** Opponents

**D** Immitate

**Answer:** D

12. **Select the option that will improve the underlined part of the given sentence.**
**You are so efficient as he**

**A** as efficient as him

**B** far efficient as he

**C** so efficient as him

**D** also efficient as he

**Answer:** A

13. **Select the most appropriate meaning of the given idiom.**
**Comparing apples with oranges**

**A** Calculation of proteins

**B** Comparison between two kinds of fruits

**C** To have a health issue

**D** Unequal comparisons

**Answer:** D

SSC CGL Free Mock Test (Latest Pattern)

Downloaded from cracku.in

14. **Select the most appropriate option to fill in the blank.**
**Their new house costed them _____ hundred and fifty-six thousand pounds.**

**A** a

**B** the

**C** an

**D** few

**Answer:** A

15. **Select the most appropriate meaning of the underlined word in the given sentence.**
**The new software provides a perfect solution to the complex issues pertaining to pick up and delivery.**

**A** Promoting

**B** Denying

**C** Trusting

**D** Referring

**Answer:** D

16. **Select the option that will improve the underlined part of the given sentence.**
**Shrija enquired about his daughter's reputation.**

**A** assessed about his daughter's strength

**B** condemned about his daughter's well-being

**C** poked about his daughter's role

**D** asked about his daughter's character

**Answer:** D

## SSC CHSL Important Questions and Answers (Download PDF)

17. **Sentences of a paragraph are given below in jumbled order. Arrange the sentences in the correct order to form a meaningful and coherent paragraph.**
**A.In its most humble function, it is a necessary guide without which progress from place to place would be a ceaseless experiment; it is a sustenance without which organised society would be impossible, thus the Road moves and controls all history.**
**B.The Road is one of the great fundamental institutions of mankind.**
**C.It is the Road which controls the development of strategies and fixes the sites of battles. It is the Road that gives framework to all economic development. It is the Road which is the channel of all trade, and, what is more important, of all ideas.**
**D.Not only is the Road one of the great human institutions because it is fundamental to social existence, but also because its varied effects appear in every department of the State. It is the Road which determines the sites of many cities and the growth and nourishment of all.**

**A** BDCA

**B** DBAC

**C** CDAB

**D** ABCD

Downloaded from cracku.in

**Answer:** A

18. **Select the option that can be used as a one-word substitute for the given group of words.**
**A sudden unsteady movement ; a stagger**

**A** Lupin

**B** Lurch

**C** Lugger

**D** Lumen

**Answer:** B

19. **Select the most appropriate ANTONYM of the underlined word.**
**His poems are recondite in subject matter**

**A** brief

**B** simple

**C** mystical

**D** obscure

**Answer:** B

SSC CHSL Study Material

20. **Select the INCORRECTLY spelt word**

**A** Absolute

**B** Abscent

**C** Absorb

**D** Abstract

**Answer:** B

**Instructions [21 - 25 ]**

In the following passage, some words have been deleted. Read the passage carefully and select the most appropriate option to fill in each blank.

In everyday language, the phrase 'sleepwalking' can be used (1)_____ informally and symbolically to describe a lack of energy or attention. However, for (2)_____ infants and adults, sleepwalking is a genuine disorder with serious (3)_____. Sleepwalking, also known as somnambulism, is a sleep-related behaviour condition that causes people to walk or execute other (d:_____ acts while they are still partly sleeping. It is more (5)_____ in children than in adults, and it is more likely to develop if a person has a family history of the illness, is sleep deprived or has many nightly awakenings.

21. **Select the most appropriate option to fill in blank number 1:**

**A** neither

**B** like

**C** both

Downloaded from cracku.in

**D** to

**Answer:** C

22. **Select the most appropriate option to fill in blank number 2:**

**A** both

**B** some

**C** few

**D** all

**Answer:** B

SSC CHSL Free App

23. **Select the most appropriate option to fill in blank number 3:**

**A** impetus

**B** impulsions

**C** repercussions

**D** causes

**Answer:** C

24. **Select the most appropriate option to fill in blank number 4:**

**A** comprehensive

**B** complicated

**C** compound

**D** combined

**Answer:** B

25. **Select the most appropriate option to fill in blank number 5.**

**A** triumphant

**B** prevalent

**C** swift

**D** hidden

**Answer:** B

## Daily Free SSC Practice Set

## General Intelligence

Downloaded from cracku.in

26. **In a certain code language, 'CHILD' is written as '6169248' and 'GUEST' is written as '142153840'. How will 'BOOK' be written in that language?**

**A** 2303011

**B** 41522

**C** 4151522

**D** 23011

**Answer:** C

Free SSC Study Material (18,000 Solved Questions)

27. **Select the option that is related to the fifth number in the same way as the second number is related to the first number and the fourth number is related to the third number.**
**4 : 80 :: 7 : 392 :: 5 : ?**

**A** 148

**B** 136

**C** 162

**D** 150

**Answer:** D

28. **Which of the following letter-clusters will replace the question mark (?) in the given series to make it logically complete?**
**YXZ, VUW, SRT, POQ, ?**

**A** LMN

**B** MLN

**C** NML

**D** LNM

**Answer:** B

29. **How many triangles are there in the given figure?**

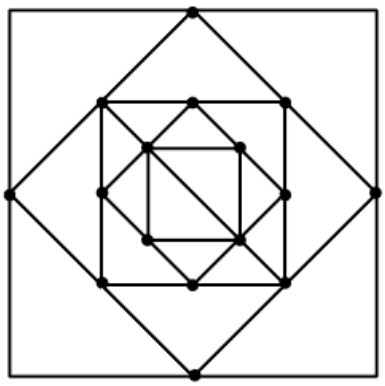

**A** 25

**B** 28

Downloaded from cracku.in

**C** 24

**D** 22

**Answer:** C

1500+ Very Important Free SSC Solved Questions

30. **Which of the following numbers will replace the question mark (?) in the given series?**
**4, 8, 5, ?, 15, 90**

**A** 18

**B** 13

**C** 22

**D** 20

**Answer:** D

31. **Select the option that is related to the fifth term in the same way as the second term is related to the first term and the fourth term is related to the third term.**
**GREATLY : ERGAYLT :: MIXTURE : XIMTERU :: TROUBLE : ?**

**A** BORTUEL

**B** ORTUEBL

**C** TUELBOR

**D** ORTUELB

**Answer:** D

32. **Select the correct mirror image of the given combination when the mirror is placed at XY as shown.**

**A** 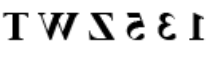

**B**

**C**

**D**

**Answer:** A

SSC Exam Update Videos & Free Study Material (YouTube Channel)

33. **Which letter-cluster will replace the question mark (?) to complete the given series?**
**NHMS, HNOU, ?, HNSY, NHUA**

Downloaded from cracku.in

**A** HNOX

**B** NHSX

**C** HNPY

**D** NHQW

**Answer:** D

34. **Three Statements are given followed by Three conclusions numbered I, II and III. Assuming the statements to be true, even if they seem to be at variance with commonly known facts, decide which of the conclusions logically follow(s) from the statements.**

**Statements:**
**All towels are cloths.**
**No cloth is a blanket.**
**Some blankets are cushions.**

**Conclusions:**
**I. Some towels are cushions.**
**II. No cushion is a cloth.**
**III. No towel is a blanket.**

**A** Only conclusion III follows.

**B** Only conclusion I follows.

**C** Both conclusions I and II follow.

**D** Both conclusions I and III follow.

**Answer:** A

35. **Tw o different positions of the same dice are shown, the six faces of which are marked as €, ₭, ₮, ₴, ₹, ▯. Select the symbol that will be on the face opposite to the one showing '▯'.**

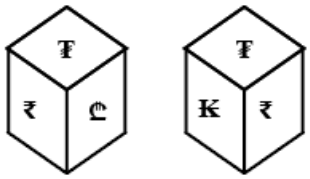


**A** ₭

**B** ₴

**C** ₮

**D** €

**Answer:** A

Latest Job Updates on Telegram - Join here

36. **Select the correct combination of mathematical signs to replace the * signs and to balance the given equation.**
**43*11*4*71*16**

**A** $-, =, +, \times$

Downloaded from cracku.in

**B** $=, -, +, \times$

**C** $+, \times, =, +$

**D** $-, \times, =, +$

**Answer:** C

37. **Select the correct combination of mathematical signs to sequentially replace the * signs and to balance the given equation.**
**57*35*7*14*2*80**

**A** $-, \div, +, \times, =$

**B** $\times, +, \div, -, =$

**C** $+, -, \times, \div, =$

**D** $+, -, \div, \times, =$

**Answer:** A

38. **The second number in the given number-pairs is obtained by performing certain mathematical operation(s) on the first number. The same operation(s) are followed in all the number-pairs EXCEPT one. Find that odd number-pair.**

**A** 16 : 8

**B** 4 : 5

**C** 9 : 6

**D** 36 : 9

**Answer:** A

Join SSC Daily Quiz Telegram Group

39. **Select the option that represents the correct order of the given words as they would appear in an English dictionary.**
**1.Resolve**
**b:Rodent**
**c:Resonant**
**d:Return**
**5.Respond**
**6.Rigidity**

**A** 1, 3, 5, 4, 2, 6

**B** 3, 1, 5, 4, 2, 6

**C** 1, 3, 5, 4, 6, 2

**D** 1, 3, 4, 5, 6, 2

**Answer:** C

Downloaded from cracku.in

40. **Select the option that is embedded in the given figure as its part (rotation is NOT allowed).**

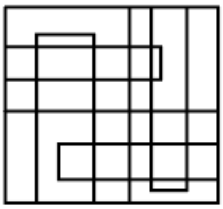

**A** 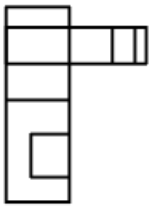

**B** 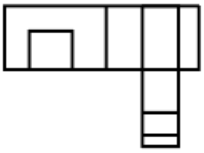

**C** 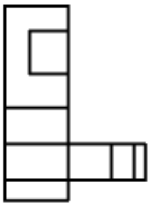

**D** 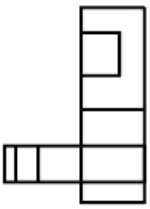

**Answer:** A

41. **The second number in the given number pairs is obtained by performing certain mathematical operation(s) on the first number. The same operation(s) are followed in all the number pairs except one. Find that odd number pair.**

**A** 53 : 2916

**B** 41 : 1765

**C** 23 : 576

**D** 19 : 400

**Answer:** B

42. **Select the correct mirror image of the given combination when the mirror is placed at MN as shown.**

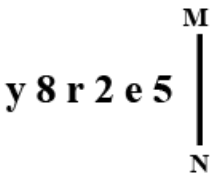


**A** 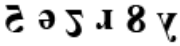

Downloaded from cracku.in

**B** 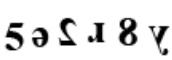

**C** 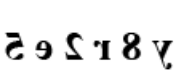

**D** 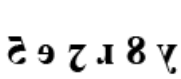

**Answer:** C

43. **Which of the following numbers will replace the question mark (?) in the given series?**
**13, 25, 38, 62, 88, 124, 163, 211, ?**

**A** 253

**B** 263

**C** 235

**D** 236

**Answer:** B

44. **Select the option that is related to the fourth term in the same way as the first term is related to the second term and the fifth term is related to the sixth term**
**7 : 58 :: ? : 370 :: 12 : 153**

**A** 20

**B** 18

**C** 21

**D** 19

**Answer:** D

SSC CHSL Free Mock Test

45. **Select the option that is related to the fifth term in the same way as the second term is related to the first term and fourth term related to third term.**
**13 : 130 :: 15 : 180 :: 27 : ?**

**A** 649

**B** 658

**C** 650

**D** 648

**Answer:** D

46. **Select the option that is related to the fourth term in the same way as the first term is related to the second term and the fifth term is related to the sixth term**
**64 : 320 :: ? : 70 :: 22 : 110**

**A** 12

**B** 14

Downloaded from cracku.in

**C** 8

**D** 17

**Answer:** B

47. **In a certain code language, 'RAIN' is written as 'MHZQ' and 'COAT' is written as 'SZNB'. How will 'ROLE' be written in that language?**

**A** DKNQ

**B** QDKN

**C** KQDN

**D** NDKQ

**Answer:** A

## SSC CHSL Prevoius Papers (DOWNLOAD PDF)

48. **In a certain code language, 'SITAR' is written as 'RHSZQ' and 'BANJO' is written as 'AZMIN'. How will 'TABLA' be written in that language?**

**A** SAZKZ

**B** SZAKZ

**C** SZKAZ

**D** SZAZA

**Answer:** B

49. **Select the option figure which is embedded in the given figure as its part (rotation is OT allowed).**

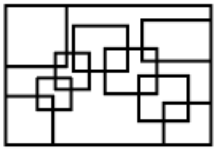

**A** 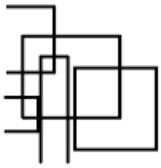

**B** 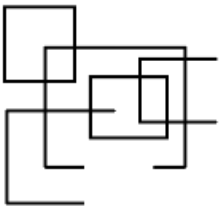

**C** 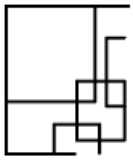

Downloaded from cracku.in

D 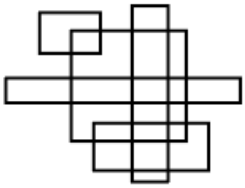

**Answer:** C

50. **Pointing to a man, Rahul said - "The son of his son is the father of my mother's daughter."**

**How is that person related to Rahul?**

A Grandpa

B father's father's brother

C Great grandfather

D father's brother

**Answer:** C

## SSC CGL Previous Papers (DOWNLOAD PDF)

## Quantitative Aptitude

51. **Study the given bar-graph and answer the question that follows.**
**The given bar-graph shows the exports and imports (in crores of rupees) of five companies in a particular financial year.**

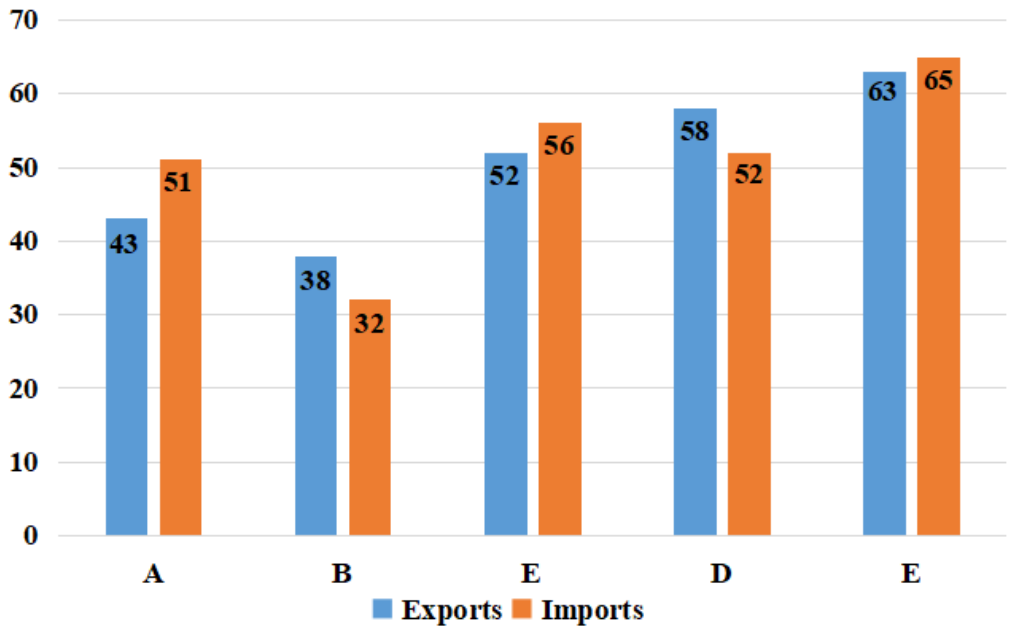


**Based on the given information, the ratio of exports to imports is highest in company _____ .**

A A

B D

C B

D E

**Answer:** C

Downloaded from cracku.in

52. **The average runs scored by Sunil in 17 innings is 37. What is his score in the 17th inning, thereby, increasing his average score by 9 runs?**

**A** 81

**B** 108

**C** 181

**D** 167

**Answer:** C

53. **In a company, there are only two types of employees: workers and officers. The average monthly salary of an officer is ₹78,000 more than the combined average monthly salary of an employee, while the combined average monthly salary of an employee is ₹42,000 more than the average monthly salary of a worker. What percentage of all the employees are officers?**

**A** 28%

**B** 35%

**C** 30%

**D** 32%

**Answer:** B

54. **If α is an acute angle, which of the following options will NOT necessarily be equal to the value of** $\sec\alpha$**?**

**A** $\frac{1}{\cos\alpha}$

**B** $\frac{1}{\sin\alpha}$

**C** $\sqrt{1+\tan^2\alpha}$

**D** $\frac{\tan\alpha}{\sin\alpha}$

**Answer:** B

SSC CHSL Important Questions and Answers (Download PDF)

55. **What is the volume of a right circular cylinder whose curved surface area is 12 π cm2 and the circumference of its base is 4 π cm?**

**A** $48\pi cm^3$

**B** $36\pi cm^3$

**C** $12\pi cm^3$

**D** $24\pi cm^3$

**Answer:** C

56. **The curved surface area of a right circular cone of radius 28 cm is 4664 cm2. What is the slant height of the cone?(Use** $\pi = \frac{22}{7}$

Downloaded from cracku.in

**A** 53 cm

**B** 56 cm

**C** 64 cm

**D** 48 cm

**Answer:** A

57. **The number 36 is increased by a certain percentage and becomes 6c: Calculate that percentage.**

**A** 50%

**B** 75%

**C** 60%

**D** 85%

**Answer:** B

## SSC CHSL Study Material

58. **Find the third proportion to 16 and 24:**

**A** 30

**B** 32

**C** 36

**D** 42

**Answer:** C

59. **If** $a + b = 25$**, then** $(a - 15)^3 + (b - 10)^3$ **is:**

**A** 125

**B** 0

**C** 625

**D** 225

**Answer:** B

60. **If** $p^3 + 3p^2 + 3p = 26$**, then the value of** $p^2 + 2p$ **is:**

**A** 8

**B** 12

**C** 10

**D** 15

**Answer:** A

Downloaded from cracku.in

61. **In a triangle ABC, CA is produced to P, $\angle BAP = 126^\circ$. If $\angle B : \angle C = 5 : 2$, the degree measures of $\angle$ B and $\angle$ C are respectively:**

**A** $90^\circ$ and $36^\circ$

**B** $84^\circ$ and $42^\circ$

**C** $78^\circ$ and $48^\circ$

**D** $70^\circ$ and $56^\circ$

**Answer:** A

62. **When the price of a watch was reduced by 20%, the number of watches sold is increased by 40%. What was the effect on the sales in percentage?**

**A** 12% increase

**B** 30% decrease

**C** 12% decrease

**D** 30% increase

**Answer:** A

63. **Study the given table and answer the question that follows.**

| | Number of Tests per Lakh | Positive Cases | Number of Patients for Ventilators |
|---|---|---|---|
| USA | 14000 | 12% | 20% |
| Spain | 12000 | 8% | 12.50% |
| Italy | 18000 | 15% | 16% |
| China | 16000 | 11% | 15% |

**The average number of tests per day per lakh in the four countries is:**

**A** 15400

**B** 15500

**C** 15600

**D** 15000

**Answer:** D

## Daily Free SSC Practice Set

64. **Simplify** $\left[\left(5\frac{1}{2}\right)^2 - \left(2\frac{3}{4}\right)^2\right] \div 2\frac{3}{4}$.

**A** $8\frac{1}{4}$

**B** $5\frac{1}{2}$

Downloaded from cracku.in

C $8\frac{3}{4}$

D $2\frac{3}{4}$

**Answer:** A

65. **The given table shows the revenue, cost and tax rate for a company for a period of 6 years. The revenue and cost are given in Rs. lakhs.**

| Year | Revenue | Cost | Tax rate |
|---|---|---|---|
| 2015 | 62 | 30 | 15% |
| 2016 | 75 | 35 | 10% |
| 2017 | 84 | 38 | 15% |
| 2018 | 86 | 40 | 20% |
| 2019 | 90 | 45 | 25% |
| 2020 | 95 | 50 | 25% |

**Profit = Revenue - Cost**
**Profit after tax for any year = Profit for that year - Tax for that year**
**Tm, for any year = Tax rate for that year $\times$ Profit for that year**
**Find the total sum (in Rs. lakhs) of profit after tax for 20 15 to 2020 .**

A 206.6

B 19b:8

C 220.2

D 215.3

**Answer:** A

66. **Simplify the following :** $6 \times \{6of(6+6)\} \div \{(6 \div 6) \times (600\% of 6)\}$

A 12

B 15552

C 108

D 6

**Answer:** A

Free SSC Study Material (18,000 Solved Questions)

67. **A book is sold for ₹1,554 by allowing a discount of 26% on its marked price. Find the marked price of the book.**

A ₹1,854

B ₹2,100

C ₹1,750

D ₹2,000

**Answer:** B

68. **Malay walks around a circular field at the rate of 7 rounds per hour,while Neha runs around it at the rate of 11 rounds per hour. They start in the same direction from the same point at 02:45 p.m. They shall first cross each other at:**

Downloaded from cracku.in

**A** 03:00 p.m.

**B** 03:05 p.m.

**C** 02:50 p.m.

**D** 03:00 a.m.

**Answer:** A

69. **A can do a piece of work alone in 96 days and B can do it alone in 104 days. In how many days can the duo, working together, complete the work?**

**A** 49.94

**B** 49.92

**C** 49.96

**D** 49.88

**Answer:** B

## 1500+ Very Important Free SSC Solved Questions

70. **The Earth makes a complete rotation about its axis in 24 hours. Through what angle will it turn in 3 hours 30 minutes?**

**A** $60^\circ$

**B** $65^\circ$

**C** $50^\circ$

**D** $5b : 5^\circ$

**Answer:** D

71. **What is the compound interest on ₹20,000 for 9 months at the rate of 4% per annum, when interest is compounded quarterly?**

**A** ₹610

**B** ₹606.02

**C** ₹609.05

**D** ₹605

**Answer:** B

72. **The marked price of a shirt is ₹2,150. Let two successive discounts offered by the store be 10% and 'x%'. If the selling price of the shirt is ₹1,505, then calculate the value of 'x'. [Give your answer correct to two decimal places.]**

**A** 24.44%

**B** 24.24%

**C** 22.22%

Downloaded from cracku.in

**D** 22.42%

**Answer:** C

SSC Exam Update Videos & Free Study Material (YouTube Channel)

73. **Romesh opened a fixed deposits account in his bank for 3 years by depositing ₹80,000.The bank has promised to pay him compound interest annually at the rate of 7% per annum. What is the maturity value of his FDR? (Nearest to a ₹)**

**A** ₹98,003

**B** ₹98,970

**C** ₹98,010

**D** ₹98,900

**Answer:** A

74. **If the number 5X8146Y is divisible by 88, then what is the value of X?**

**A** 3

**B** 1

**C** 2

**D** 4

**Answer:** A

75. **A man bought a piece of land for ₹48,000. He sold two-fifth of it at a loss of 10%. At what gain percentage (rounded off to 1 decimal place) should he sell the remaining land to earn an overall profit of 42%?**

**A** 76.7%

**B** 84.3%

**C** 79.5%

**D** 89.8%

**Answer:** A

Latest Job Updates on Telegram - Join here

## General Awareness

76. **Ustad Bade Ghulam Ali Khan is also known as _____.**

**A** Sitar maestro

**B** Alla Rakha

**C** the Bharat Ratna recipient

**D** Tansen of the 20th century

**Answer:** D

Downloaded from cracku.in

Join SSC Daily Quiz Telegram Group

77. **In which track and field event is the hop used?**

**A** Javelin throw

**B** High jump

**C** Triple jump

**D** Broad jump

**Answer:** C

78. **In December 2021, who among the following inaugurated the 'Bharat Darshan Park' in Delhi, which has replicas of major monuments from across the country created by a group of artists?**

**A** Amit Shah

**B** Dharmendra Pradhan

**C** Nirmala Sitharaman

**D** Smriti Irani

**Answer:** A

79. **Which of the following books is an autobiography of the Indian novelist Khushwant Singh?**

**A** My Confession

**B** Truth, Love & A Little Malice

**C** My Story

**D** My Autobiography

**Answer:** B

80. **A batsman can be given out in_____ ways.**

**A** 6

**B** 8

**C** 10

**D** 5

**Answer:** C

81. **The Sangeet Natak Akademi is a body working under which of the following ministries of the Government of India?**

**A** Ministry of Education

**B** Ministry of Home Affairs

**C** Ministry of Culture

Downloaded from cracku.in

D Ministry of Tourism

**Answer:** C

82. **In cell biology, what is a large double-membraned organelle that is sometimes referred to as the 'central unit' of the cell because it contains the chromosomes that bear genetic material?**

A Peroxisome

B Nucleus

C Mitochondrion

D Lysosome

**Answer:** B

## SSC CHSL Free Mock Test

83. **Match the column A with column B.**

| Column-A (Vitamin) | Column-B (Source) |
|---|---|
| i. Vitamin A | a. Carrot, Mango, Papaya |
| ii. Vitamin B | b. Whole grain bread and nuts |
| iii. Vitamin C | c. Citrus fruits, red and green pepper |
| iv. Vitamin D | d. Egg yolk, soya product |

A i - b, ii - a, iii - c, iv - d

B i - c, ii - b, iii - d, iv - a

C i - b, ii - c, iii - a, iv - d

D i - a, ii - b, iii - c, iv - d

**Answer:** D

84. **Lemon juice contains _____ which when mixed with baking soda reacts to form carbon dioxide and sodium citrate causing the liquid to fizz and bubble.**

A acetic acid

B formic acid

C citric acid

D tartaric acid

**Answer:** C

85. **Rukmini Devi Arundale, awarded with Sangeet Natak Akademi Award in 1957, was a _____ dancer.**

A Bharatanatyam

B Manipuri

C Kathak

Downloaded from cracku.in

**D** Kathakali

**Answer:** A

## SSC CHSL Prevoius Papers (DOWNLOAD PDF)

86. **'The Private life of an Indian Prince' is a novel written by whom among the following authors?**

**A** Mulk Raj Anand

**B** Ruskin Bond

**C** R K Narayanan

**D** Arvind Adiga

**Answer:** A

87. **The valleys lying between the lesser Himalayas and Shivaliks are called:**

**A** Duars

**B** Tehri

**C** Terai

**D** Duns

**Answer:** D

88. **When was the Lalit Kala Akademi established?**

**A** 1965

**B** 1956

**C** 1951

**D** 1954

**Answer:** D

## SSC CGL Previous Papers (DOWNLOAD PDF)

89. **The micro finance movement in India was formally launched on a pilot basis by the _____in _____.**

**A** National Bank for Agriculture and Rural Development (NABARD); 1992

**B** National Bank for Agriculture and Rural Development (NABARD); 1994

**C** Small Industries Development Bank of India (SIDBI); 1994

**D** Small Industries Development Bank of India (SIDBI); 1992

**Answer:** A

90. **When do electrons move for the flow of charges in a conducting metallic wire?**

Downloaded from cracku.in

**A** When there is no difference of electric pressure

**B** When the charges stop flowing

**C** Only if there is a difference of electric pressure

**D** Due to gravity

**Answer:** C

91. **A Minister who for any period of _____ is not a member of either House of Parliament shall at the expiration of that period cease to be a Minister.**

**A** six consecutive months

**B** three consecutive months

**C** four consecutive months

**D** eight consecutive months

**Answer:** A

## SSC CGL Free Mock Test (Latest Pattern)

92. **A balanced diet takes care of all the following aspects, EXCEPT one. Identify the aspect.**

**A** Promotes a healthy mind

**B** Meets the RDA for all nutrients

**C** Includes nutrients in correct proportions

**D** Includes a variety of food items

**Answer:** A

93. **Which of the following novels was written by the Indian author Anuradha Roy?**

**A** Tell Her Everything

**B** Sleeping on Jupiter

**C** Midnight's Children

**D** The Illicit Happiness of Other People

**Answer:** B

94. **Which state of India launched the 'Ashirbad' scheme for education, health and maintenance of Covid orphans in June 2021?**

**A** Karnataka

**B** Kerala

**C** Maharashtra

**D** Odisha

**Answer:** D

Downloaded from cracku.in

95. **As per statistics published by National Crime Records Bureau for 2020, which state tops in total number of crime incidences against senior citizens (60 years and above)?**

**A** Maharashtra

**B** Madhya Pradesh

**C** Bihar

**D** Uttar Pradesh

**Answer:** A

96. **Ustad Bismillah Khan is best known for playing which of the following instruments?**

**A** Tambura

**B** Sitar

**C** Sarod

**D** Shehnai

**Answer:** D

97. **Sangeet Natak Akademi Award was constituted in which of the following years?**

**A** 1969

**B** 1947

**C** 1952

**D** 1961

**Answer:** C

SSC CHSL Study Material

98. **Pandit Ananda Gopal Bandopadhyay was a _____ player of the Banaras gharana.**

**A** sarangi

**B** sarod

**C** sitar

**D** tabla

**Answer:** D

99. **How is food stored in brown algae?**

**A** In the form of glucose

**B** In the form of complex carbohydrates that may be in the form of laminarin or mannitol

Downloaded from cracku.in

**C** In the form of complex lipids

**D** In the form of oil droplets

**Answer:** B

100. **Who among the following is credited with building Delhi's Lāl Quilā (Red Fort)?**

**A** Akbar

**B** Jahangir

**C** Sher Shah Suri

**D** Shah Jahan

**Answer:** D


SSC CHSL Free App

SSC CHSL Free Mock Test

SSC CHSL Prevoius Papers (DOWNLOAD PDF)

SSC CGL Previous Papers (DOWNLOAD PDF)

SSC CGL Free Mock Test (Latest Pattern)

SSC CHSL Important Questions and Answers (Download PDF)

SSC CHSL Study Material

SSC CHSL Free App

Daily Free SSC Practice Set

Free SSC Study Material (18,000 Solved Questions)

1500+ Very Important Free SSC Solved Questions

SSC Exam Update Videos & Free Study Material (YouTube Channel)

Latest Job Updates on Telegram - Join here

Join SSC Daily Quiz Telegram Group

Downloaded from cracku.in

Downloaded from cracku.in